Teoría 3º EE Vacaciones 8

NOMBRE_____

1- Clasifica e invierte estos intervalos:



_____



_____

2- Completa estos compases con figuras y silencios:



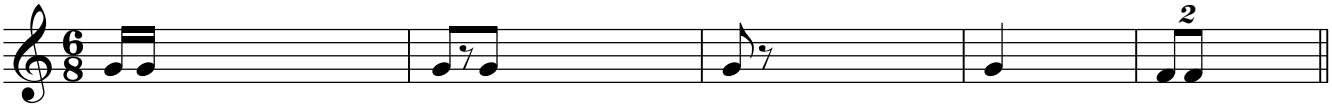

Copyright © Ana Madorrán 2011

3.- Dibuja estas tonalidades e indica la Tónica (T), la Subdominante (SD) y la Dominante (D):

Sol Mayor

Sol menor

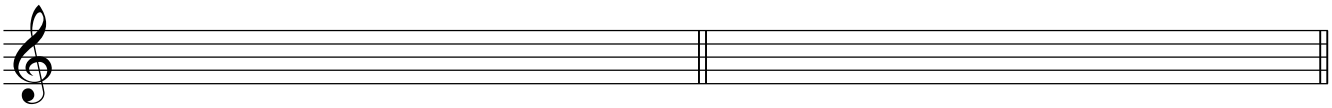

Re Mayor

Re menor

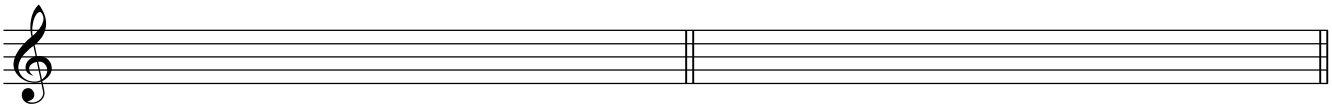

Mi menor

Mi ♭ Mayor



La Mayor

La menor

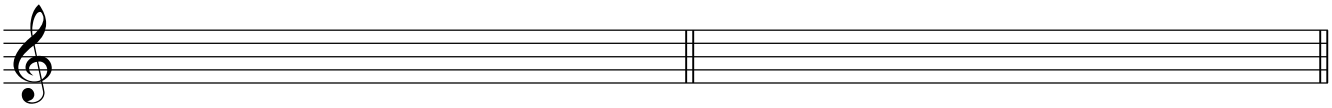

Fa Mayor

Fa ♯ menor

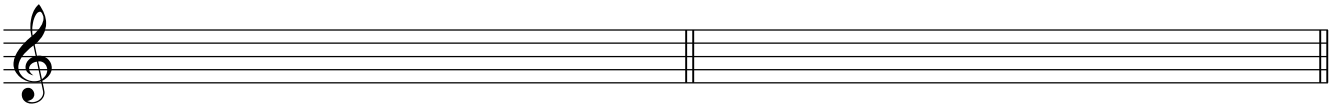

4.- ¿A qué tonalidades pertenecen estas armaduras?:

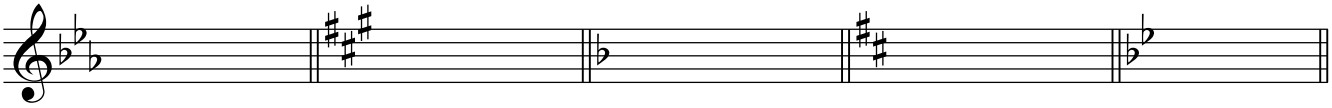

_____

_____

5.- Dibuja las armaduras de estas tonalidades:



Mi ♭Mayor Si menor Si ♭ Mayor Fa ♯ menor Sol Mayor

Copyright © Ana Madorrán 2011