Teoría 4º EE
Semana del 30 de marzo al 5 de abril

NOMBRE_____

1.-Clasifica e invierte estos intervalos:



_____

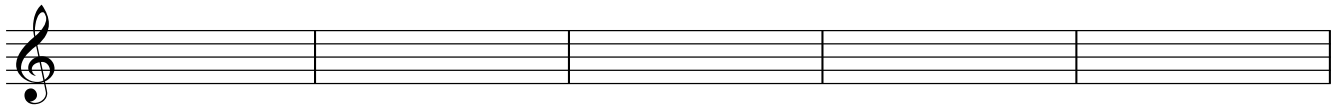

_____

2.- Dibuja la nota que falta a estos intervalos, y luego inviértelos:

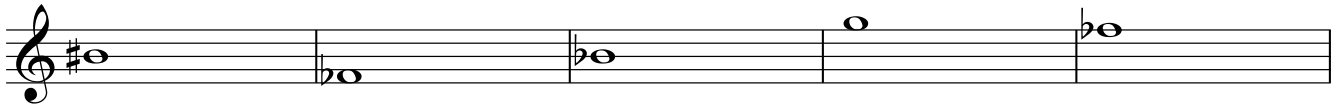

3ª Mayor asc. 6ª Mayor asc. 4ª Justa asc. 2ª menor desc. 5ª Justa desc.



_____

3.- A qué tonalidades corresponden estas armaduras:

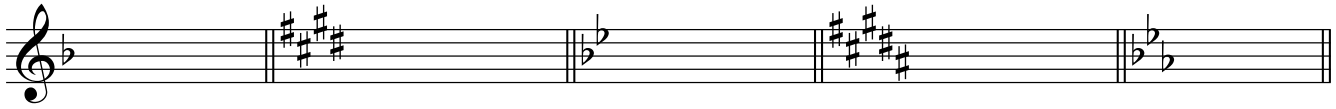

_____

_____

4.- Dibuja las armaduras de estas tonalidades:



Si♭ menor Fa ♯ menor Do ♯ Mayor Sol Mayor La♭ Mayor

5.- Dibuja estas escalas:

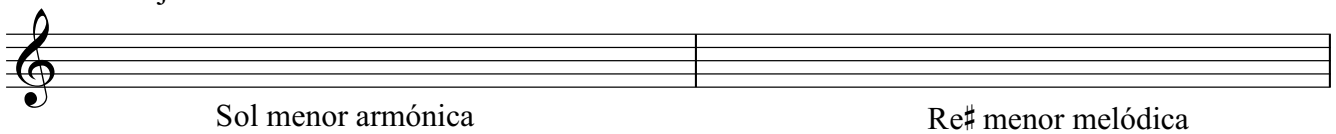

Sol menor armónica Re♯ menor melódica

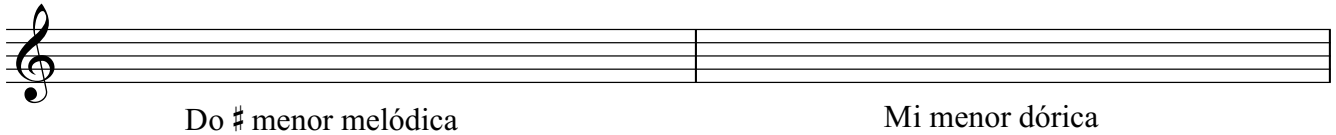

Do ♯ menor melódica Mi menor dórica

Ana Madorrán©2020

b.- Dibuja los cuatro tipos de Fa♯ menor. Pon el nombre de cada uno de ellos.

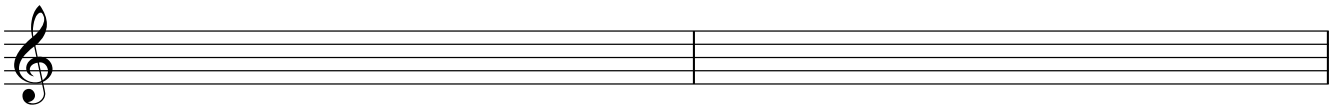

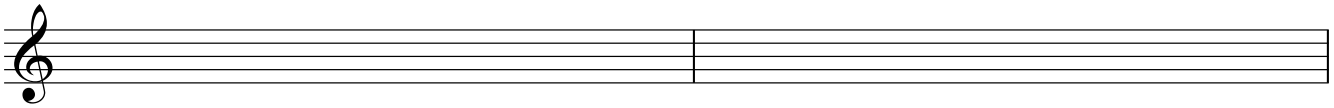

6.- Dibuja, nombra y clasifica los siguientes acordes de Mi♭ Mayor:

I III IV V VII



7.- Construye estos acordes:



P.M. P.m. 5ª Au. 5ª Dis. 7ª Dom.

8.- Clasifica estos acordes:

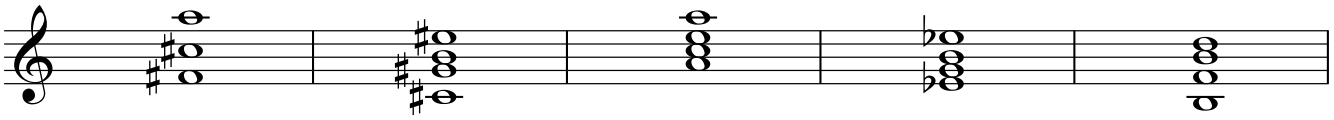

9.- Completa estos compases con figuras y silencios:



10.- Escribe estas notas en clave de Fa en 4ª línea. Recuerda que deben ser unísonos:



Tonalidad:



Tonalidad:



Ana Madorrán©2020