Teoría 4º EE
Semana del 13 al 19 de abril

NOMBRE_____

1.-Clasifica e invierte estos intervalos:



_____



_____

2.- Dibuja la nota que falta a estos intervalos, y luego inviértelos:

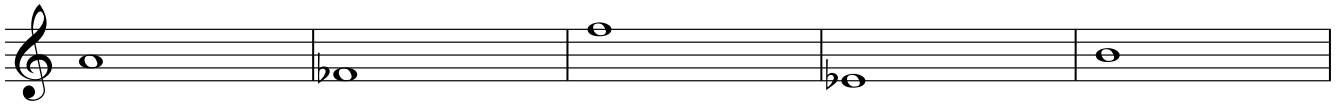

3ª Mayor asc. 5ª Justa asc. 7ª Mayor desc. 2ª menor asc. 4ª Dis. desc.

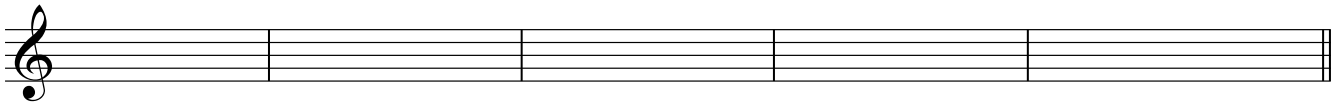

_____

3.- A qué tonalidades corresponden estas armaduras:



_____

_____

4.- Dibuja las armaduras de estas tonalidades:

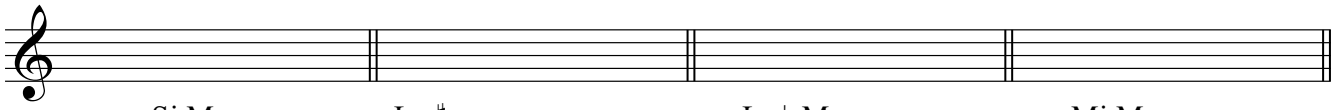

Si Mayor La ♯ menor La ♭ Mayor Mi Mayor

5.- Dibuja y nombra los 4 tipos de Re ♭ Mayor:

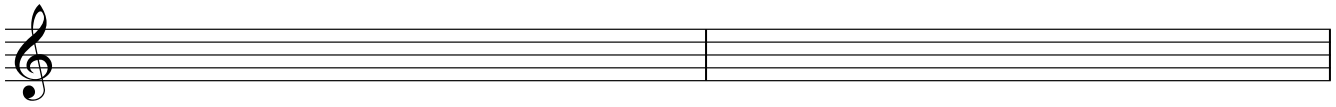

_____

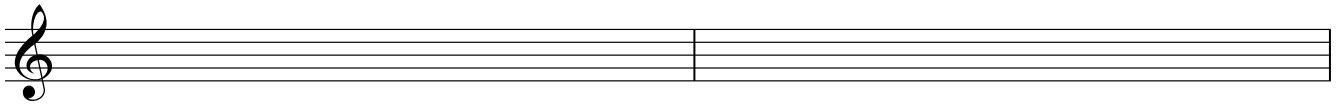

_____

Ana Madorrán©2020

b.- Dibuja los cuatro tipos de La ♯ menor. Pon el nombre de cada uno de ellos.

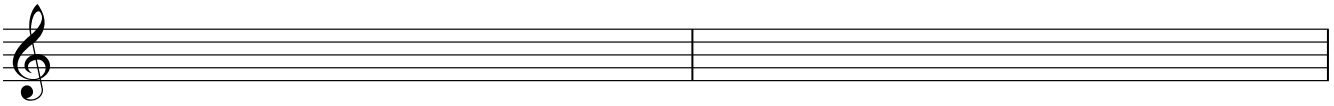

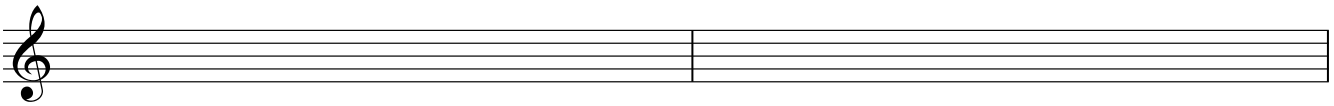

6.- Dibuja, nombra y clasifica los siguientes acordes de Re menor armónica:

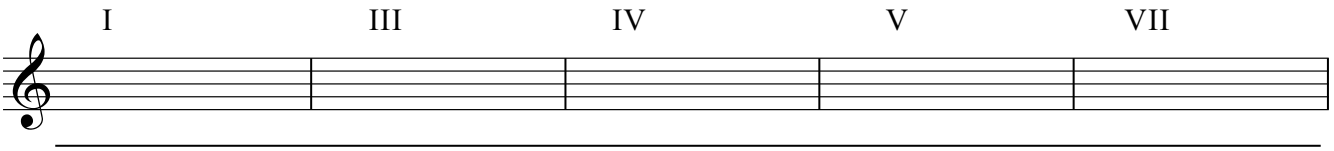

7.- Construye estos acordes:



P.M. P.m. 5ª Au. 5ª Dis. 7ª Dom.

8.- Clasifica estos acordes:



9.- Completa estos compases con figuras y silencios:



Vale un pulso

10.- Escribe estas notas en clave de Fa en 4ª línea. Recuerda que deben ser unísonos:



Ana Madorrán©2020