NOMBRE _____

1- Clasifica e invierte estos intervalos:









2.- Completa estos compases con figuras y silencios:





3.- Dibuja las escalas de Do Mayor y La menor. Indica los tonos y semitonos, la tónica y la dominante:

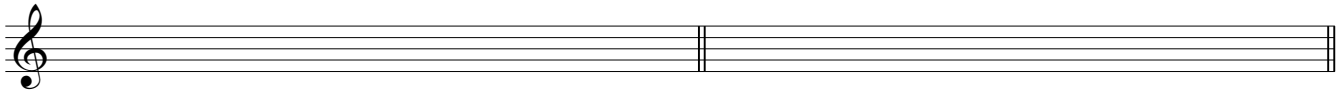

Copyright © Ana Madorrán 2009